All rights reserved. No part of this publication may be reproduced, distributed, or transmitted in any form or by any means, electronic, mechanical, photocopying, recording or otherwise, or stored in any retrieval system of any nature without the permission of cracku.in, application for which shall be made to support@cracku.in

Downloaded from cracku.in

SSC CHSL 5th August 2021 Shift-2

English Language

1. **Select the most appropriate option to substitute the underlined segment in the given sentence. If there is no need to substitute it, select 'No substitution required'.**
   What are the options available of me for a change of career?

A options available over me

B options available from me

C options available to me

D No substitution required

Answer: C

2. **Select the option that can be used as a one-word substitute for the given group of words.**
   Instrument that measures the altitude of the land surface

A Altimeter

B Thermometer

C Barometer

D Chronometer

Answer: A

3. **Select the most appropriate option to substitute the underlined segment in the given sentence. If there is no need to substitute it, select 'No substitution required'.**
   If the box breaking the glass bottle will be shattered.

A If the box break

B If the box breaks

C If the box broke

D No substitution required

Answer: B

4. **Sentences of a paragraph are given below in jumbled order. Arrange the sentences in the right order to form a meaningful and coherent paragraph.**
   A. Due to this tilt as the Earth wobbles around the Sun, different points of the Earth receive more or less sunlight.
   B. Furthermore, we also wouldn't have solstices or equinoxes.
   C. We know that seasons are caused by the Earth having a slight tilt on its axis.
   D. If the Sun just shone directly on the Equator all year long, we would be left without seasons.

A CBDA

B ABCD

C ACBD

D CADB

Downloaded from cracku.in

Answer: D

SSC CHSL Free Mock Test

5. **Select the most appropriate ANTONYM of the given word.**
   Naive

A Simple

B Sophisticated

C Immature

D Unsuspicious

Answer: B

6. **The following sentence has been divided into parts. One of them may contain an error. Select the part that contains the error from the given options. If you don't find any error, mark 'No error' as your answer.**
   The energy required / for perform various functions of the body / is obtained from food.

A for perform various functions of the body

B is obtained from food

C The energy required

D No error

Answer: A

7. **Select the INCORRECTLY spelt word.**

A Aptitude

B Attitude

C Altitude

D Attaractive

Answer: D

SSC CHSL Prevoius Papers (DOWNLOAD PDF)

8. **Select the most appropriate word to fill in the blank.**
   A micromanager frequently demands reports and updates leaving little room for subordinates to take _____ on their own.

A decisions

B results

C verdicts

D decrees

Answer: A

Downloaded from cracku.in

9. **Sentences of a paragraph are given below in jumbled order. Arrange the sentences in the right order to form a meaningful and coherent paragraph.**
A. Games involved gladiators fighting wild animals or each other.
B. Inside, tiered seating encircled the arena, where animals were caged and stage sets prepared.
C. Inaugurated in AD 80, the 50,000-seat Colosseum is also known as the Flavian Amphitheatre.
D. Rome's great gladiatorial arena is the most monumental of the city's ancient sights.

A ADCB

B BCAD

C DABC

D DCBA

Answer: D

10. **Select the most appropriate ANTONYM of the given word.**
Compel

A Induce

B Influence

C Dissuade

D Persuade

Answer: C

SSC CGL Previous Papers (DOWNLOAD PDF)

11. **Select the most appropriate word to fill in the blank.**
The first van was sent as a _____ to mislead the thugs.

A persuasion

B decoy

C determination

D temptation

Answer: B

12. **Select the most appropriate synonym of the given word.**
Salient

A Sturdy

B Navigable

C Marine

D Noticeable

Answer: D

13. **Select the most appropriate synonym of the given word.**
Apathetic

Downloaded from cracku.in

A Instantaneous

B Irrelevant

C Irregular

D Indifferent

Answer: D

SSC CGL Free Mock Test (Latest Pattern)

14. **Select the most appropriate meaning of the given idiom.**
Butter fingers

A To be very efficient

B To like rich food

C To cook well

D To be clumsy

Answer: D

15. **The following sentence has been divided into parts. One of them may contain an error. Select the part that contains the error from the given options. If you don't find any error,**
mark 'No error' as your answer.
The monkeys swinged / on the branches and / jumped over the compound wall.

A The monkeys swinged

B No error

C on the branches and

D jumped over the compound wall

Answer: A

16. **Select the option that expresses the given sentence in reported speech.**
Neil Armstrong said, "It's a small step for man but a giant leap for mankind."

A Neil Armstrong said that a small step for man can be giant leap for mankind.

B Neil Armstrong had said that a small step for man is a giant leap for mankind.

C Neil Armstrong said that it was a small step for man but a giant leap for mankind.

D Neil Armstrong says that was a small step for man but a giant leap for mankind.

Answer: C

SSC CHSL Important Questions and Answers (Download PDF)

17. **Select the option that expresses the given sentence in passive voice.**
Have you submitted the papers at the post office?

Downloaded from cracku.in

A Have the papers been submit by you at the post office?

B Had the papers submitted by you to the post office?

C Has the papers been submitted by you at the post office?

D Have the papers been submitted by you at the post office?

Answer: D

18. **Select the option that can be used as a one-word substitute for the given group of words.**
A place or scene of activity, debate, or conflict

A Stadium

B Floor

C Arena

D Site

Answer: C

19. **Select the INCORRECTLY spelt word.**

A Whisper

B Secluded

C Readible

D Twinkle

Answer: C

SSC CHSL Study Material

20. **Select the most appropriate meaning of the given idiom.**
Large-hearted

A Corrupt

B Unhealthy

C Overweight

D Generous

Answer: D

Instructions [21 - 25]

In the following passage, some words have been deleted. Select the most appropriate option to fill in each blank.

Comprehension:
In the generation of hydroelectric power, water is collected or (1) _____ at a higher elevation and led downward (2) _____ large pipes to a lower elevation; the difference in elevations is (3)
_____ as the head. At the end of its passage down the pipes, the falling water (4) _____ turbines to rotate. The turbines in turn drive generators, (5) _____ convert the turbines' mechanical energy into electricity.

21. **Select the most appropriate option to fill in blank no.1.**

Downloaded from cracku.in

A hoarded

B amassed

C stored

D deposited

Answer: C

22. **Select the most appropriate option to fill in blank no.2.**

A beyond

B above

C through

D over

Answer: C

SSC CHSL Free App

23. **Select the most appropriate option to fill in blank no.3.**

A known

B being known

C told

D know

Answer: A

24. **Select the most appropriate option to fill in blank no.4.**

A produces

B begins

C effects

D causes

Answer: D

25. **Select the most appropriate option to fill in blank no.5.**

A they

B whose

C which

D who

Answer: C

Downloaded from cracku.in

Daily Free SSC Practice Set

General Intelligence

26. **Select the option that is related to the third term in the same way as the second term is related to the first term.**
QUORATE : AEOQRTU :: SANDBOX : ?

A DNASXOB

B ASDNOBX

C ABDNOSX

D BOXSAND

Answer: C

Free SSC Study Material (18,000 Solved Questions)

27. **Select the option in which the numbers share the same relationship as that shared by the given pair of numbers.**
12 : 20

A 30 : 42

B 24 : 36

C 42 : 57

D 18 : 28

Answer: A

28. **How many triangles are there in the given figure?**

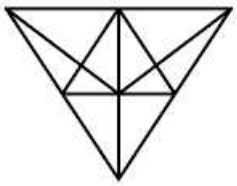

A 24

B 28

C 22

D 26

Answer: B

29. **The sequence of folding a piece of paper and the manner in which the folded paper has been cm is shown in the following figures. How would this paper look when unfolded ?**

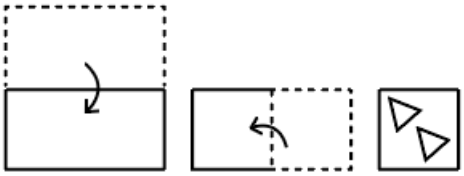

Downloaded from cracku.in

A

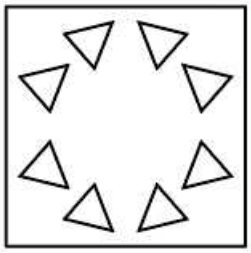

B

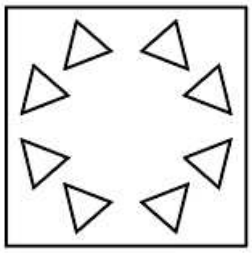

C

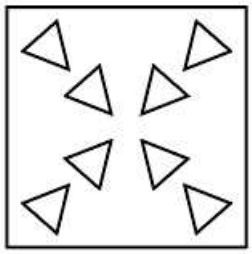

D

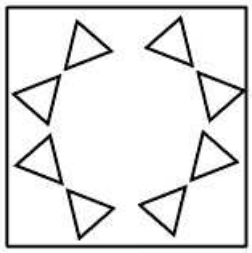

Answer: B

1500+ Very Important Free SSC Solved Questions

30. **Select the figure from among the given options that can replace the question mark(?) to the following series.**

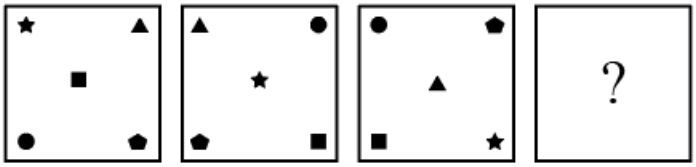

A



B



Downloaded from cracku.in

C 

D 

Answer: C

31. **Select the correct option that indicates the arrangement of the given words in the order in which they appear in an English dictionary.**
    1. Expanse
    2. Expansive
    3. Expandable
    4. Expansion
    5. Expanded

A 3-2-1-5-4

B 3-5-1-4-2

C 1-2-5-3-4

D 5-3-1-2-4

Answer: B

32. **Tushar is the only son of Jitendra, and Kirti is the daughter of Jitendra's father's brother. Suhani is the sister of Tushar. How is Suhani related to Kirti?**

A Sister

B Cousin

C Aunt

D Niece

Answer: D

SSC Exam Update Videos & Free Study Material (YouTube Channel)

33. **Select the option that is embedded in the given figure (rotation is NOT allowed).**

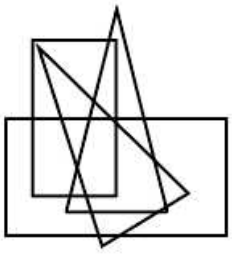

Downloaded from cracku.in

A

B

C

D

Answer: C

34. **Select the option in which the numbers are related in the same way as are the numbers of the following set.**
(72, 56, 42)

A (80, 48, 24)

B (132, 110, 90)

C (80, 68, 58)

D (126, 102, 80)

Answer: B

35. **Select the Venn diagram that best represents the relationship between the following classes.**
Women, Mothers, Sisters

A 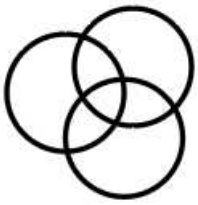

Downloaded from cracku.in

B 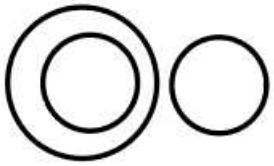

C 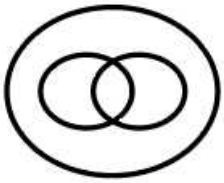

D 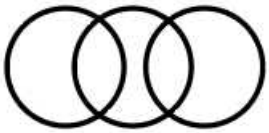

Answer: C

Latest Job Updates on Telegram - Join here

36. **Read the given statements and conclusions carefully. Assuming that the information given in the statements is true, even if it appears to be at variance with commonly known facts, decide which of the given conclusions logically follow(s) from the statements.**
Statements:
Some ducks are hens.
Some hens are chickens.
Conclusions:
I. Some ducks are chickens.
II. Some hens are ducks.

A Neither conclusion I nor II follows.

B Only conclusion II follows.

C Both conclusions I and II follow.

D Only conclusion I follows.

Answer: B

37. **Three different positions of the same dice are shown. Select the le1ter that will be on the face opposite to the face having the letter E.**



A A

B D

C F

D C

Answer: C

38. **Select the option in which the words share the same relationship as that shared by the given pair of words.**
Virus : Ebola

Downloaded from cracku.in

A Bacteria : Plague

B Mosquito : Jaundice

C Fungi : Diarrhoea

D Season : Common cold

Answer: A

Join SSC Daily Quiz Telegram Group

39. **A notebook costs ₹12 each. A pen costs ₹9 each. Tina spends ₹123 on a total of 11 pieces of these articles. How many notebooks did she purchase?**

A 11

B 8

C 6

D 9

Answer: B

40. **In a certain code language, ENVELOPE is written as IQZHPRTH. How will INTIMATE be written in that language?**

A NRYMREYI

B KPVKOCVG

C LPWPCWG

D MQXLQDXH

Answer: D

41. **Select the option in which the numbers are related in the same way as are the numbers of the following set.**
221 : 348 : 517

A 995 : 1326 : 1723

B 1005 : 1336 : 1733

C 1331 : 1728 : 2744

D 343 : 512 : 729

Answer: B

42. **Which two digits and signs need to be interchanged so as to balance the given equation?**
$97 \div 24 - 16 \times 5 + 37 = 53$

A 2 and 3; $\div$ and $-$

B 7 and 6; $+$ and $-$

Downloaded from cracku.in

C 4 and 7; ÷ and +

D 2 and 3; + and ×

Answer: B

43. **Four letter-clusters have been given in the options, out of which three are alike in some manner and one is different. Select the letter-cluster that is different.**

A ORVA

B EHLQ

C ILPU

D KOSW

Answer: D

44. **Four numbers have been given in the options, out of which three are alike in some manner and one is different. Select the number that is different.**

A 345

B 514

C 733

D 218

Answer: C

SSC CHSL Free Mock Test

45. **Four words have been given, out of which three are alike in some manner and one is different. Select the word that is different.**

A Geology

B Entomology

C Mycology

D Genomics

Answer: A

46. **Select the number from among the given options that can replace the question mark (?) in the following series.**
12, 22, 40, 74, 140, ?

A 280

B 268

C 270

D 274

Answer: C

Downloaded from cracku.in

47. **Select the correct mirror image of the given figure when the mirror is placed at the right side.**

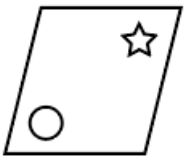

A 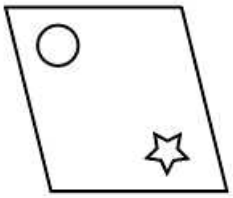

B 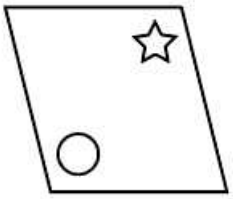

C 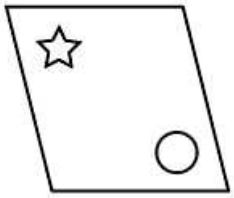

D 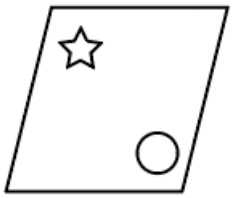

Answer: C

SSC CHSL Prevoius Papers (DOWNLOAD PDF)

48. **Select the option that is related to the third word in the same way as the second word is related to the first word.**
Hindi : Devanagari :: English : ?

A Greek

B British

C Persian

D Latin

Answer: D

49. **In a certain code language, BOOTLACE is coded as 49960372 and CAPELIN is coded as 7382015. How will TAPIOCA be coded in that language?**

A 3673819

B 6381973

C 6582975

Downloaded from cracku.in

D 5381963

Answer: B

50. **Select the combination of letters that when sequentially placed in the blanks of the given series will complete the series.**
O _ E _ O Z _ T _ Z _ T

A O E T Z T

B E Z T O E

C Z T E O E

D T E Z O Z

Answer: C

SSC CGL Previous Papers (DOWNLOAD PDF)

Quantitative Aptitude

51. **The successive discounts 18% , 10% and 15% are equivalent to a single discount of:**

A 39.25%

B 37.27%

C 45.16%

D 41.32%

Answer: B

SSC CGL Free Mock Test (Latest Pattern)

52. **If $9x^2 - 6x + 1 = 0$, then the value of $27x^3 + (27x^3)^{-1}$ will be:**

A 8

B 4

C 2

D 1

Answer: C

Downloaded from cracku.in

53. Study the following graph and answer the question that follows.
Marks scored by five students A, B, C, D and E in three subjects (Maths, English and Physics)

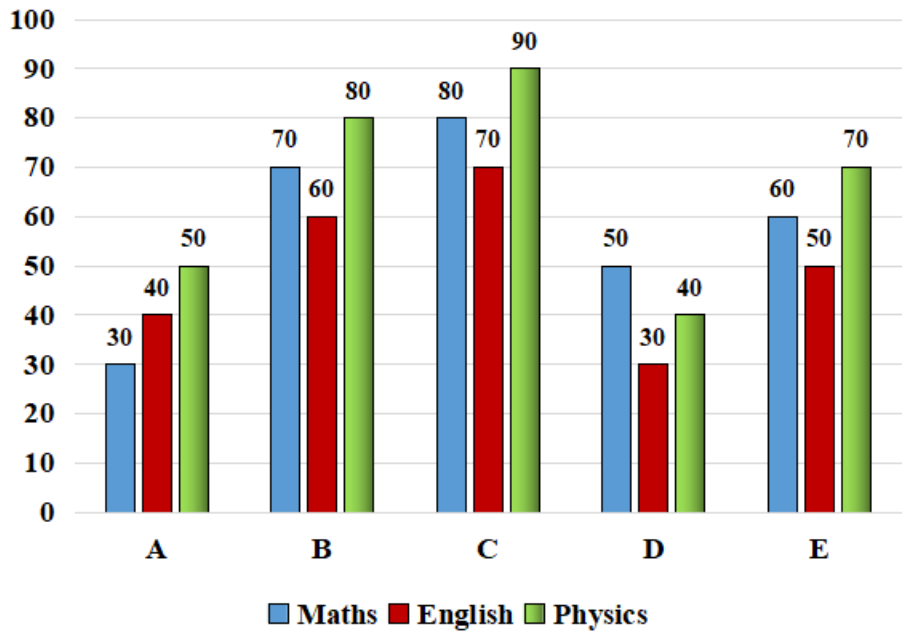

What are the approximate average marks obtained by C?

A 65

B 75

C 80

D 70

Answer: C

54. In $\triangle ABC$, the length of BC is less than twice the length of AB by 2 cm. The length of AC exceeds the length of AB by 6 cm. The perimeter is 60 cm. The length (in cm) of the lergest side of the triangle ABC is:

A 28

B 26

C 30

D 20

Answer: B

SSC CHSL Important Questions and Answers (Download PDF)

55. If $\cos\theta = \frac{P^2-1}{P^2+1}, 0^\circ < \theta < 90^\circ$, then $\operatorname{cosec}\theta$ is equal to:

A $\frac{2P}{1-P^2}$

B $\frac{2P}{1+P^2}$

C $\frac{1+P^2}{2P}$

D $\frac{1-P^2}{2P}$

Downloaded from cracku.in

Answer: C

56. **What will be the compound interest (in ₹) on a s11m of ₹7,200 for 18 months at a ra te of 20% per annum. if the interest is compounded half-yearly (nearest to an integer)?**

A 3,238

B 2,338

C 2,833

D 2,383

Answer: D

57. **A circle is inscribed iu a triangle ABC. It touches sides AB, BC and AC at points R, P and Q, respectively. If AQ = 6.5 cm, PC = 7.5 cm and BR = 9 cm, then the perimeter(in cm) of the triangle ABC will be:**

A 55

B 27.5

C 46

D 23

Answer: C

SSC CHSL Study Material

58. **If** $(4x-5)^3+(x-2)^3+27(2x-5)^3=9(4x-5)(x-2)(2x-5)$**, then the value of** $\left(x+\frac{3}{2}\right)$ **will be:**

A $\frac{3}{2}$

B $\frac{1}{2}$

C $\frac{7}{2}$

D $\frac{5}{2}$

Answer: C

59. **If** $9a^2+4b^2+49c^2+18=2(2b+28x-3a)$**, then the value of** $(a+2b-c)$ **will be:**

A $\frac{11}{21}$

B $\frac{2}{21}$

C $\frac{26}{21}$

D $\frac{5}{21}$

Answer: B

60. **If** $7\sin^2\theta+3\cos^2\theta=4, 0^\circ<\theta<90^\circ$**, then the value of** θ **will be:**

Downloaded from cracku.in

A 60°

B 45°

C 75°

D 30°

Answer: D

SSC CHSL Free App

61. **The value of** $61\frac{3}{5} \div \left[40 \div 2of5 + 27 \div \frac{1}{3} - \left(78 \div 3\frac{1}{3}\right)\right]$ **is:**

A $\frac{11}{25}$

B 1

C $\frac{41}{25}$

D -5

Answer: B

62. **Study the given graph and answer the question that follows.**

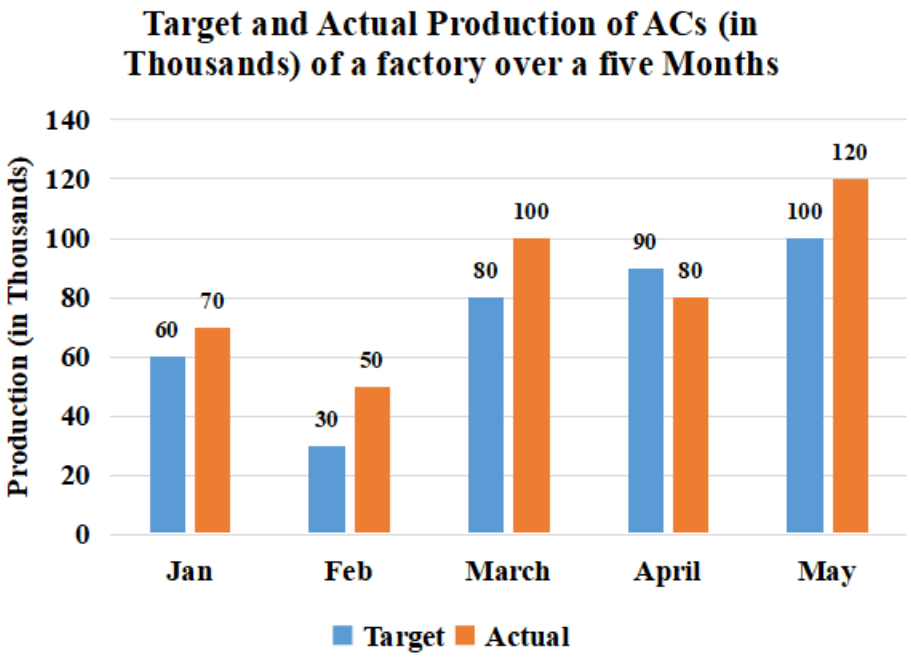

In which month is the actual production of ACs 20% more than its target production?

A February

B May

C January

D March

Answer: B

Downloaded from cracku.in

63. From a rectangular sheet of dimensions 32 cm $\times$ 18 cm, a square of side 3 cm is cut from the four corners of the sheet and a box is made. The volume of the box is:

A 946 cm^2

B 936 cm^2

C 1305 cm^2

D 1300 cm^2

Answer: B

Daily Free SSC Practice Set

64. A train travels at a speed of 66 km/h and halts at five junctions for a certain time. It covers a distance of 1485 km in one day. For how long (in minutes) does the train stop at each junction, if it halts for the same period of time at all the junctions?

A 15

B 18

C 12

D 20

Answer: B

65. The income of A is 40% less than that of B. If A gets 25% rise in his income and B gets 40% rise in his income, then the percentage increase (correct to two decimal places) in the combined incomes of A and B will be:

A 35.19

B 37.86

C 31.67

D 34.38

Answer: D

66. If PA and PB are tangents drawn to a circle with center O at A and B from external point P such that $\angle APB = 78^\circ$, then $\angle OAB$ is equal to:

A 39°

B 12°

C 36°

D 29°

Answer: A

Free SSC Study Material (18,000 Solved Questions)

Downloaded from cracku.in

67. Study the graph which shows the daily wages (in ₹) with number of workers and answer the question that follows.

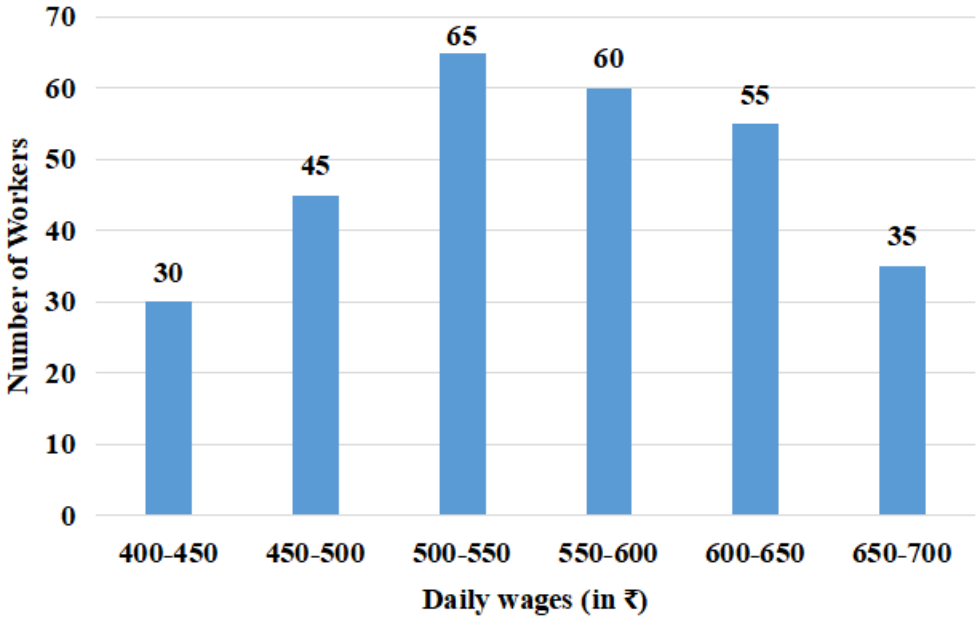

If the ratio of the total number of workers whose daily wages are less than ₹450 to the total number of workers whose daily wages are ₹ 600 or above is a : b, then what is the difference between b and a?

A 2

B 1

C 0

D 3

Answer: A

68. If a nine-digit number 489x6378y is divisible by 72, then the value of $\sqrt{8x+6y}$ will be:

A 10

B 4

C 6

D 8

Answer: D

69. The value of $\frac{3\tan^2 60^\circ+\sec^2 30^\circ-\sin^2 45^\circ}{(\cos 15^\circ+\sin 75^\circ)(\sec 15^\circ+\operatorname{cosec} 75^\circ)}$ is:

A $\frac{5}{12}$

B $\frac{65}{24}$

C $\frac{13}{12}$

D $\frac{59}{24}$

Answer: D

Downloaded from cracku.in

70. The average of eighteen numbers is 42. The average of the last ten numbers is 40 and that of the first five numbers is 44. The seventh number is 6 less than the sixth and 7 less than the eighth number. The average of the si.,th and the eighth number is:

A 46.5

B 47.5

C 45

D 48

Answer: B

71. Study the given graph which shows the Target and Actual production of ACs' (in thousands) of a factory over five months and answer the question that follows.

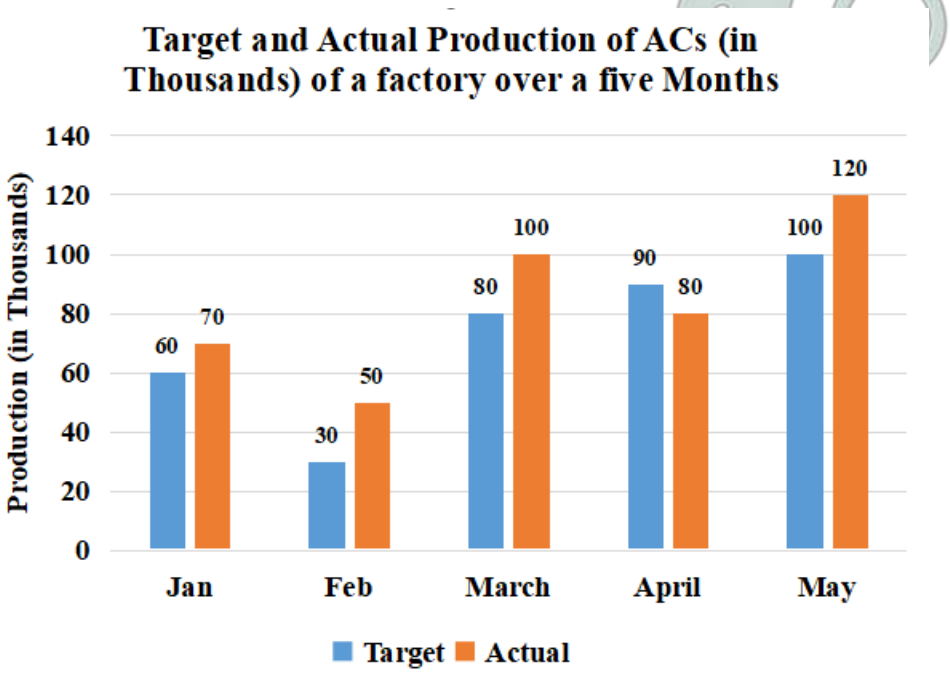

The ratio of the combined target production of ACs from January to April to that of the actual production of ACs from March to May is:

A 13 : 15

B 19 : 15

C 15 : 13

D 15 : 19

Answer: A

72. In $\triangle ABC, \angle A = 66^\circ$. If I is the incenter of the triangle, then the measure of $\angle BIC$ will be:

A 123°

B 109°

C 119°

D 112°

Downloaded from cracku.in

Answer: A

SSC Exam Update Videos & Free Study Material (YouTube Channel)

73. **A can do 60% of a work in 18 days, while B can do 40% of the same work in 10 days. Both work together for 10 days only. C compleled the remaining work in 4 days. In how many days will C complete the same work?**

A 12

B 15

C 25

D 18

Answer: B

74. **A bought an article for ₹4,800 and sold it at a loss of 30°. With this amount, he bought another article and sold it at a gain of 60%. What was his overall gain/loss?**

A Loss 18%

B Gain 12%

C Gain 10%

D Loss 15%

Answer: B

75. **The ratio of the incomes of A and B is 7 : 5. A and B save ₹4,000 and ₹3,500, respectively. If the expenditure of B is half the expeuditure of A, then the total income of A and B (in ₹) will be:**

A 10,000

B 13,500

C 12,000

D 15,000

Answer: C

Latest Job Updates on Telegram - Join here

General Awareness

76. **Who among the following politicians was the Home Minister of India in Rajiv Gandhi's cabinet from 1986 to 1989?**

A Madhavrao Scindia

B Ajit Kumar Panja

C Buta Singh

D Ashoke Kumar Sen

Answer: C

Downloaded from cracku.in

77. **Which maharaja of Manipur signed the Instrument of Accession with the Government of India?**

A Kulachandra Singh

B Bodhchandra Singh

C Nara Singh

D Gambhir Singh

Answer: B

78. **Where was the Khelo India Ice Hockey Tournament held in January 2021?**

A Lungnak

B Shargole

C Drass

D Chiktan

Answer: D

79. **The world's only floating national park, Keibul Lamjao National Park, is located in _____.**

A Manipur

B Assam

C Nagaland

D Tripura

Answer: A

80. **Which of the following is a Kharif crop in North India and a Rabi crop in South India?**

A Wheat

B Sesamum

C Finger millet

D Barley

Answer: B

81. **Which of the following is a single user operating system?**

A Windows 7

B MS-DOS

C Windows NT

Downloaded from cracku.in

D Linux

Answer: B

82. **In January 2021, the Defence Research Development Organisation (DRDO) developed India's first indigenous machine pistol called 'Asmi' in collaboration with _____.**

A Army War College, Mhow

B Central Ordnance Depot, Jabalpur

C Infantry School, Mhow

D College of Military Engineering, Pune

Answer: C

SSC CHSL Free Mock Test

83. **How many terabytes make one petabyte?**

A 1048

B 1042

C 1084

D 1024

Answer: D

84. **Public Sector Banks account for about _____ of market share in Indian banking as per the Economic Survey 2019-20.**

A 70%

B 50%

C 80%

D 40%

Answer: A

85. **Who among the following did the Sports Authority of India appoint as the middle-and-long distance coach of the Indian athletics team in January 2021?**

A Avinash Sable

B Radhakrishnan Nair

C Adille Sumariwalla

D Nikolai Snesarev

Answer: D

SSC CHSL Prevoius Papers (DOWNLOAD PDF)

86. **The inertia of an object is measured by its _____.**

Downloaded from cracku.in

A volume

B speed

C mass

D area

Answer: C

87. **Which of the following beaches was NOT awarded the international 'Blue Flag' certification by Foundation of Environment Education, Denmark as of October 2020?**

A Kappad

B Ghoghla

C Talasari

D Rushikonda

Answer: C

88. **Which web portal and mobile application did the Ministry of Housing and Urban Affairs, Government of India, launch in December 2020?**

A e-Uparjan

B e-Rozgar

C e-Sampada

D e-Dharti

Answer: C

SSC CGL Previous Papers (DOWNLOAD PDF)

89. **Who among the following was a World War II veteran, also associated with cricket?**

A Brad Friedel

B Alan Burgess

C Ivan Cordoba

D Erik Karlsson

Answer: B

90. **Which of the following Articles of the Constitution of India deals with the organisation of agriculture and animal husbandry?**

A Article 84

B Article 92

C Article 29

D Article 48

Downloaded from cracku.in

Answer: D

91. **The Sufi shrine Charar-e-Sharief (or Sharif) is located near _____ city.**

A Srinagar

B Mumbai

C Hyderabad

D Lucknow

Answer: A

SSC CGL Free Mock Test (Latest Pattern)

92. **Which of the following watershed development projects is sponsored by the Central Government aims at enabling the rural population to conserve water?**

A Jal Kranti Abhiyan

B Haryali

C Neeru-Meeru

D Arvary Pani Sansad

Answer: B

93. **Which was the first empire in ancient India to use elephants in its war on a large scale?**

A Shunga

B Chola

C Kushans

D Magadha

Answer: D

94. **'Purusha Sukta' is a hymn from which Veda?**

A Atharvaveda

B Yajurveda

C Rigveda

D Samaveda

Answer: C

SSC CHSL Important Questions and Answers (Download PDF)

95. **Which of the following was the country in focus at the 51st International Film Festival of India held in Goa in January 2021?**

A Myanmar

Downloaded from cracku.in

B Nepal

C Bangladesh

D Bhutan

Answer: C

96. **Who discovered blood circulation?**

A Charles Darwin

B David Baltimore

C William Harvey

D Rosalind Franklin

Answer: C

97. **Which of the following diseases is caused by Leishmania, a protozoan organism?**

A Sleeping sickness

B Kala-azar

C Malaria

D Acne

Answer: B

SSC CHSL Study Material

98. **Which of the following is a main species of moist deciduous forests?**

A Sandalwood

B Khejri

C Amaltas

D Neem

Answer: A

99. **A Shadava Raga has only _____ notes in its scale.**

A seven

B eight

C five

D six

Answer: D

100. **As per Union Budget 2021, 9% of the government revenue will be spent on _____.**

Downloaded from cracku.in

A defence

B interest payments

C pensions

D centrally sponsored schemes

Answer: D

SSC CHSL Free App

SSC CHSL Free Mock Test

SSC CHSL Prevoius Papers (DOWNLOAD PDF)

SSC CGL Previous Papers (DOWNLOAD PDF)

SSC CGL Free Mock Test (Latest Pattern)

SSC CHSL Important Questions and Answers (Download PDF)

SSC CHSL Study Material

SSC CHSL Free App

Daily Free SSC Practice Set

Free SSC Study Material (18,000 Solved Questions)

1500+ Very Important Free SSC Solved Questions

SSC Exam Update Videos & Free Study Material (YouTube Channel)

Latest Job Updates on Telegram - Join here

Join SSC Daily Quiz Telegram Group

Downloaded from cracku.in